Adı : .....
Soyadı: .....

2. Sınıf
Matematik

Doğal Sayılar
Onluğa Yuvarlama-2

Çocuk topu en yakın hangi kaleye yuvarlamalıdır?

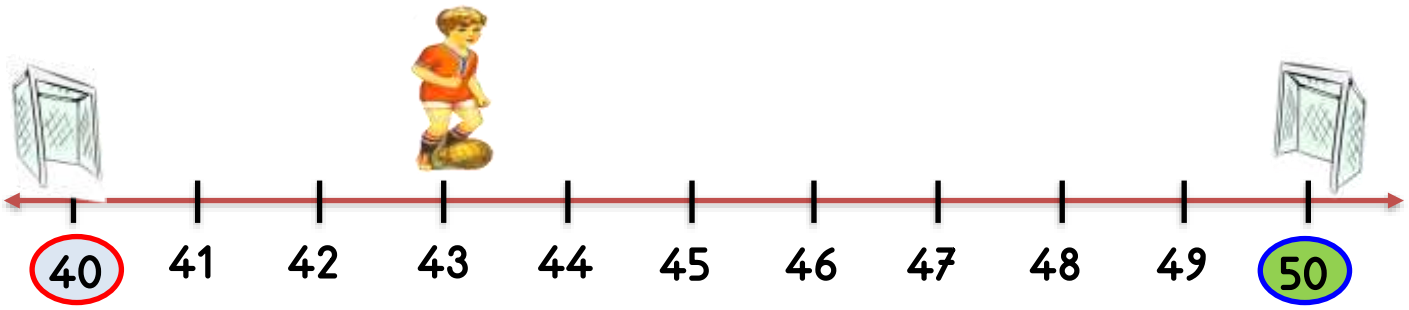

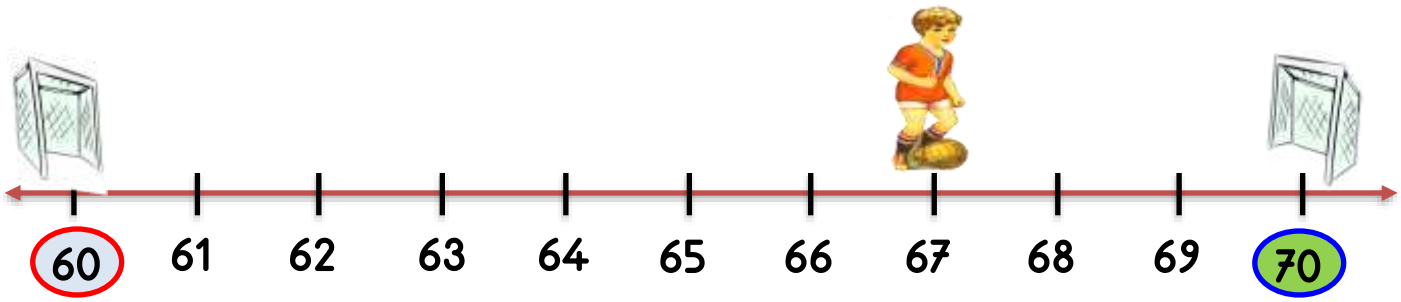



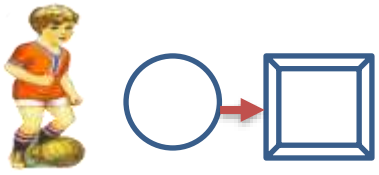

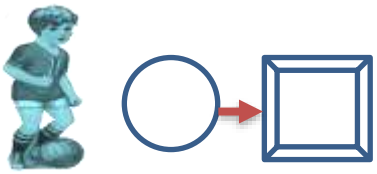

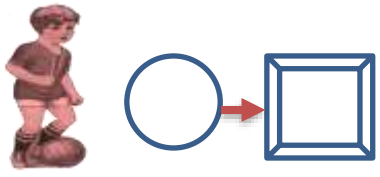

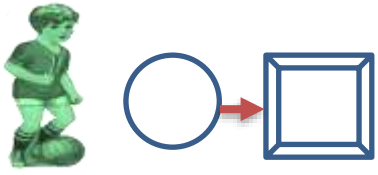

Adı : .....
Soyadı: .....

2. Sınıf
Matematik

Doğal Sayılar
Onluğa Yuvarlama-2

60 ile 70 arasındaki sayıları en yakın onluğa yuvarlayınız.

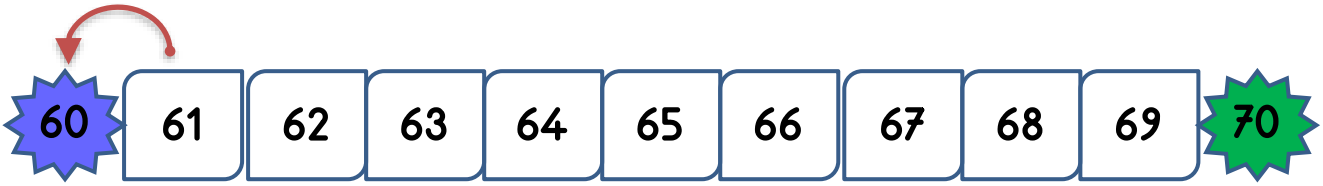

61 →	64 →	67 →
62 →	65 →	68 →
63 →	66 →	69 →

80 ile 90 arasındaki sayıları en yakın onluğa yuvarlayınız.



83 →	86 →	82 →
88 →	81 →	87 →
89 →	84 →	85 →

COPYRIGHT