Adı : .....
Soyadı: .....

3. Sınıf
Matematik

Zaman Ölçme-4



5 dakika önce .....

5 dakika sonra .....



5 dakika önce .....

5 dakika sonra .....



5 dakika önce .....

5 dakika sonra .....



10 dakika önce .....

10 dakika sonra .....



10 dakika önce .....

10 dakika sonra .....



10 dakika önce .....

10 dakika sonra .....



15 dakika önce .....

15 dakika sonra .....



15 dakika önce .....

15 dakika sonra .....



15 dakika önce .....

15 dakika sonra .....

Mustafa Kabul

Adı : .....
Soyadı: .....

3. Sınıf
Matematik

Zaman Ölçme-4



20 dakika önce .....

20 dakika sonra .....



20 dakika önce .....

20 dakika sonra .....



20 dakika önce .....

20 dakika sonra .....



30 dakika önce .....

30 dakika sonra .....



30 dakika önce .....

30 dakika sonra .....



30 dakika önce .....

30 dakika sonra .....



1 saat önce .....

1 saat sonra .....



1 saat önce .....

1 saat sonra .....



1 saat önce .....

1 saat sonra .....

Adı : .....
Soyadı: .....

3. Sınıf
Matematik

Zaman Ölçme-4

Aşağıdaki dijital saatin 5 dakika sonrasını çiziniz.

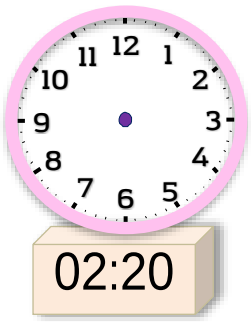

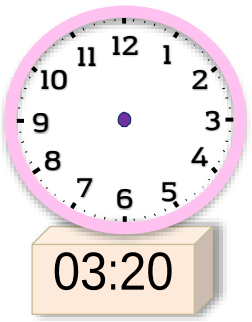

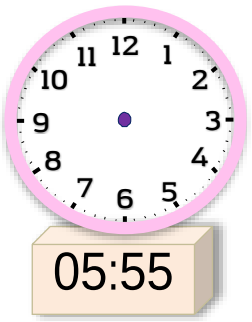



Aşağıdaki dijital saatin 10 dakika sonrasını çiziniz.







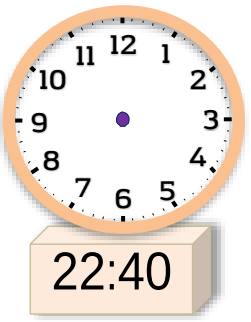

Aşağıdaki dijital saatin 10 dakika öncesini çiziniz.

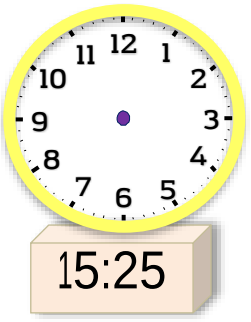







Aşağıdaki dijital saatin 20 dakika sonrasını çiziniz.

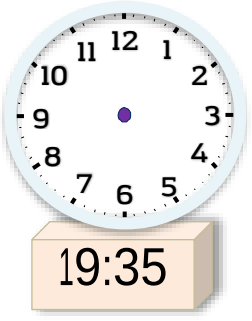

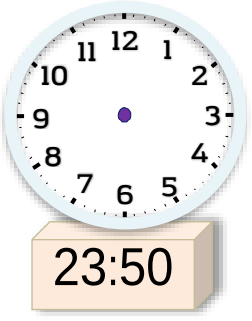

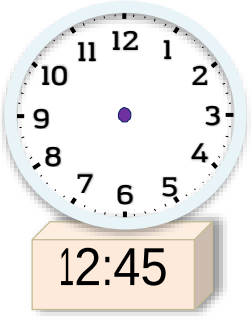

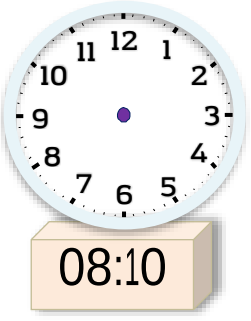

COPYRIGHT
Mustafa Kabul