MATEMATİK SAATLER SÜREÇ DEĞERLENDİRME

ADI SOYADI:.....TARİH:.....VELİ İMZASI:.....

1. Verilen saatlerin kaç olduğunu altına yazın. (20)

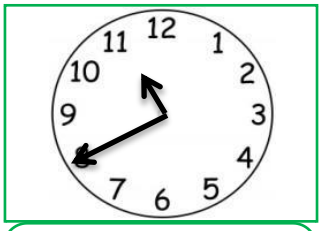

Ö. Ö. : .....
Ö. S. : .....



Ö. Ö. : .....
Ö. S. : .....



Ö. Ö. : .....
Ö. S. : .....

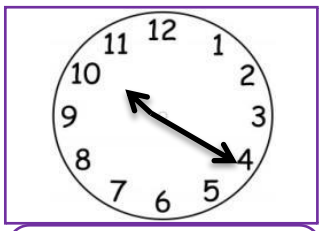

Ö. Ö. : .....
Ö. S. : .....

2. Verilen saatleri çiziniz. (40)

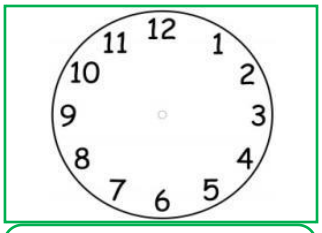

08 : 15
.....

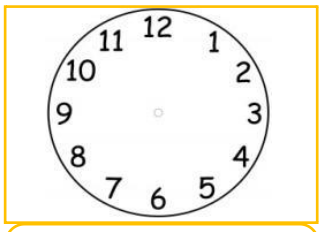

22 : 20
.....

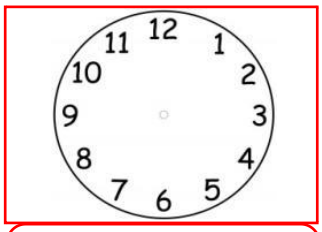

03 : 50
.....

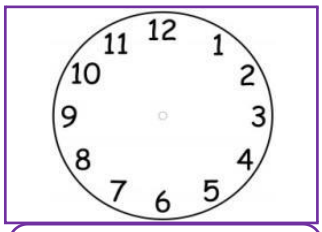

16 : 55
.....

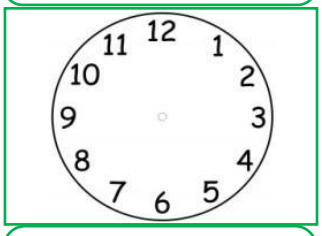

..... : .....
Biri elli geçiyor

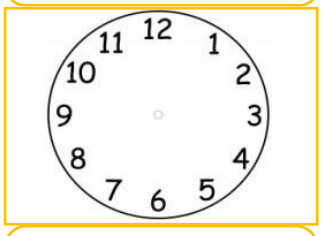

..... : .....
Yirmiyi beş geçiyor

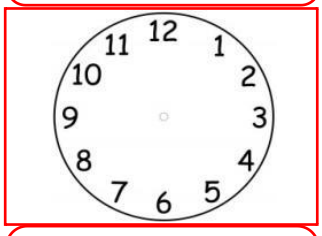

..... : .....
On sekizi on geçe

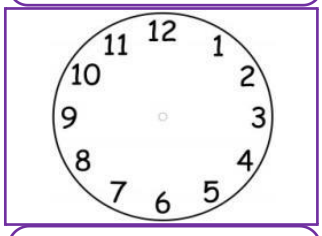

..... : .....
Dokuzu yirmi geçe

3. Romen rakamların karşısına sayıları yazın. (40)

I. ..... II. ..... III. ..... IV. ..... V. .....

VI. ..... VII. ..... VIII. ..... IX. ..... X. .....

XI. ..... XII. ..... XIII. ..... XIV. ..... XV. .....

XVI. ..... XVII. ..... XVIII. ..... XIX ..... XX. .....